All rights reserved. No part of this publication may be reproduced, distributed, or transmitted in any form or by any means, electronic, mechanical, photocopying, recording or otherwise, or stored in any retrieval system of any nature without the permission of cracku.in, application for which shall be made to support@cracku.in

Downloaded from cracku.in

SSC CHSL 19th April 2021 Shift-2

English Language

1. **Select the most appropriate meaning of the given idiom.**
   Getting butterflies in one's stomach

A To be confident of oneself

B To be anxious and nervous

C To be suspicious of someone

D To be very angry with someone

Answer: B

2. **Select the most appropriate meaning of the given idiom.**
   A Herculean task

A An important task

B An immediate task

C A task requiring great effort

D A task for brave people

Answer: C

3. **Select the correct indirect form of the given sentence.**
   Dr. Chanda said, "I will definitely write about this case in the medical journal."

A Dr. Chanda said that I will definitely write about this case in the medical journal.

B Dr. Chanda said that she will definitely write about this case in the medical journal.

C Dr. Chanda said that she would definitely write about that case in the medical journal.

D Dr. Chanda said that she would definitely be writing about this case in the medical journal.

Answer: C

4. **Given below are four jumbled sentences. Out of the given options, pick the one that gives their correct order.**
   A. Jody went to the kitchen.
   B. A pan of milk stood on the kitchen shelf.
   C. Jody poured some milk into a bowl and held it out to the fawn.
   D. The fawn followed him.

A ABDC

B BDAC

C BACD

D ADBC

Answer: D

Downloaded from cracku.in

5. **Select the most appropriate ANTONYM of the given word.**
   HASTE

A urgency

B drive

C delay

D pace

Answer: C

6. **Select the most appropriate option to substitute the underlined segment in the given sentence. If there is no need to substitute it, select 'No substitution'.**
   It was a second hand car but it hasn't been use much.

A No substitution

B hadn't been used

C hasn't been used

D wasn't using

Answer: B

7. **Select the most appropriate ANTONYM of the given word.**
   PLUNGE

A dive

B duck

C rise

D fall

Answer: C

SSC CHSL Prevoius Papers (DOWNLOAD PDF)

8. **Select the most appropriate option to substitute the underlined segment in the given sentence. If there is no need to substitute it, select 'No substitution'.**
   The medicines have arrived, isn't it?

A haven't they

B have they

C No substitution

D didn't they

Answer: A

9. **Select the INCORRECTLY spelt word.**

Downloaded from cracku.in

A celebrate

B separate

C celibate

D segragate

Answer: D

10. **Select the most appropriate option to fill in the blank.**
Of all the emotions that _____ through me as I stood on the summit of Everest, the dominant one, I think, was humility.

A heaved

B pitched

C surged

D slammed

Answer: C

SSC CGL Previous Papers (DOWNLOAD PDF)

11. **Select the most appropriate option to fill in the blank.**
We had our time of peace and goodwill, a time I will _____ as long as I live.

A esteem

B cherish

C think

D care

Answer: B

12. **Select the option which means the same as the group of words given.**
A person who composes the sequence of steps and moves for a dance performance

A director

B calligrapher

C cartographer

D choreographer

Answer: D

13. **Select the INCORRECTLY spelt word.**

A parallal

B principal

C plural

Downloaded from cracku.in

D practical

Answer: A

SSC CGL Free Mock Test (Latest Pattern)

14. **Select the correct passive form of the given sentence.**
I spotted this clock in a junk shop.

A This clock has been spotted by me in a junk shop.

B A junk shop was spotted in this clock by me.

C This clock was spotted by me in a junk shop.

D This clock has spotted me in a junk shop.

Answer: C

15. **In the given sentence, identify the segment which contains the grammatical error.**
He part the grass at the place where he had seen the deer.

A He part the grass

B where he had seen

C at the place

D the deer

Answer: A

16. **Select the most appropriate synonym of the given word.**
PROBE

A ignore

B investigate

C reply

D explain

Answer: B

SSC CHSL Important Questions and Answers (Download PDF)

17. **In the given sentence, identify the segment which contains the grammatical error.**
Bags and purses were thoroughly checking at the entrance to the theatre.

A were thoroughly checking

B at the entrance

C to the theatre

D Bags and purses

Answer: A

Downloaded from cracku.in

18. **Select the most appropriate synonym of the given word.**
BRACE

A let go

B loosen

C weaken

D fortify

Answer: D

19. **Select the option which means the same as the group of words given.**
Animals that live in water

A aerial

B aquatic

C terrestrial

D arboreal

Answer: B

SSC CHSL Study Material

20. **Given below are four jumbled sentences. Out of the given options, pick the one that gives their correct order.**
A. But Romulous said it should be built on another.
B. Remus said the city should be built on one hill.
C. However, they quarreled on where to make the city.
D. Romulous and Remus went to the hills to build the city of Rome.

A BACD

B DBAC

C DCBA

D BDAC

Answer: C

Instructions [21 - 25]

In the following passage, some words have been deleted. Fill in the blanks with the help of the alternatives given. Select the most appropriate option for each blank.

Comprehension:
Many people believe that animals possess a sixth sense and know (1) _____ the earth is going to shake. Some experts (2) _____ that animals' more acute hearing helps (3) _____ to hear or feel the earth's vibrations. (4) _____ can sense an approaching disaster long before humans (5) _____ what's going on.

21. **Select the most appropriate option for blank no. 1.**

A why

B when

C where

Downloaded from cracku.in

D how

Answer: B

22. **Select the most appropriate option for blank no. 2.**

A believe

B are believing

C believing

D believed

Answer: A

SSC CHSL Free App

23. **Select the most appropriate option for blank no. 3.**

A us

B them

C they

D one

Answer: B

24. **Select the most appropriate option for blank no. 4.**

A We

B Them

C You

D They

Answer: D

25. **Select the most appropriate option for blank no. 5.**

A reflect

B realise

C renew

D restore

Answer: B

Daily Free SSC Practice Set

General Intelligence

Downloaded from cracku.in

26. **Select the option in which the words share the same relationship as that shared by the given pair of words.**
Butcher : Knife

A Hairdresser : Hammer

B Electrician : Chisel

C Teacher : Chalk

D Carpenter : Scissors

Answer: C

Free SSC Study Material (18,000 Solved Questions)

27. **The sequence of folding a piece ofpaper and the mannerin which the folded paper has been cut is shown in the following figures. How would this paper look when unfolded?**

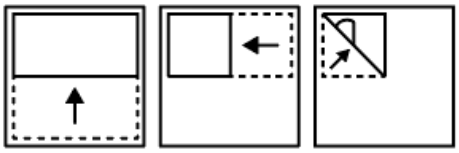

A

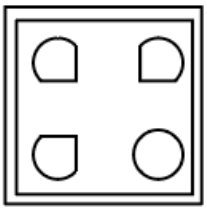

B

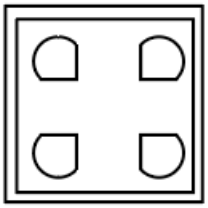

C

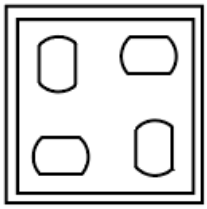

D

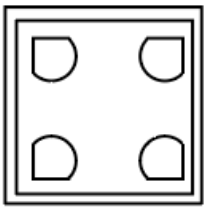

Answer: B

28. **In a certain code language, IMPUDENT is written as PFXMHAWK. How will ABNORMAL be written in that language?**

A EXRKPOOX

B YDLQJUID

C EKRXPOXO

Downloaded from cracku.in

D YQLDIUJD

Answer: A

29. **Select the option that is related to the third term in the same way as the second term is related to the first term.**
MONKEY : XDJMNL : : TIGER : ?

A QDFHP

B QDFHR

C QDFHS

D DQFHS

Answer: C

1500+ Very Important Free SSC Solved Questions

30. **Four letter-clusters have been given, out of which three are alike in some manner and one is different. Select the letter-cluster that is different.**

A SWDZ

B RVGC

C FJQM

D GKPL

Answer: B

31. **Select the correct option that indicates the arrangement of the given words in the order in which they appear in an English dictionary.**
1. Misappropriate
2. Misbehave
3. Microorganism
4. Miscellaneous
5. Mineralize

A 3, 5, 2, 1, 4

B 3, 2, 4, 1, 5

C 3, 5, 1, 2, 4

D 3, 1, 4, 2, 5

Answer: C

32. **Select the option that is related to the third word in the same way as the second word is related to the first word.**
Death : Accident : : Starvation : ?

A Hunger strike

B Joy

C Unhappy

D Angry

Downloaded from cracku.in

Answer: A

SSC Exam Update Videos & Free Study Material (YouTube Channel)

33. **Four words have been given, out of which three are alike in some manner and one is different. Select the word that is different.**

A Slavery

B Convenience

C Choice

D Autonomy

Answer: A

34. **Select the option in which the given figure is embedded (rotation is NOT allowed).**

A

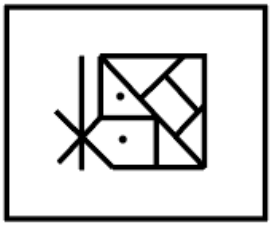

B

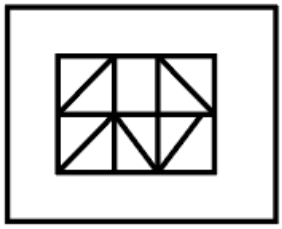

C

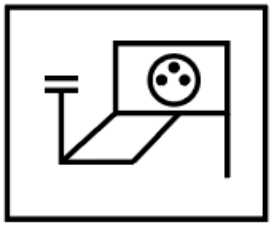

D

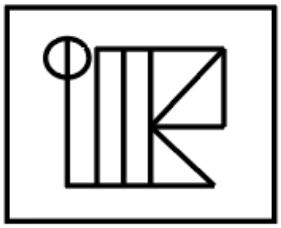

Answer: B

35. **Four numbers have been given, out of which three are alike in some manner and one is different. Select the number that is different.**

A 3437

B 7437

Downloaded from cracku.in

C 7415

D 5453

Answer: B

Latest Job Updates on Telegram - Join here

36. **Select the number from among the given options that can replace the question mark (?) in the following series.**
3, 7, 13, 25, 47, 83, ?

A 273

B 173

C 137

D 237

Answer: C

37. **Three different positions of the same dice are shown. Select the number that will be on the face opposite to the face showing '1'.**

A 4

B 5

C 6

D 3

Answer: B

38. **Read the given statements and conclusions carefully. Assuming that the information given in the statements is true, even if it appears to be at variance with commonly known facts, decide which of the given conclusions logically follow(s) from the statements.**
Statements:
All balls are fans.
No fan is a player.
Some players are wickets.
Conclusions:
I. Some players are fans.
II. Some wickets are balls.
III. Some fans are balls.

A Only conclusion I follows

B Only conclusion II follows

C Both conclusions II and III follow

D Only conclusion III follows

Answer: D

Downloaded from cracku.in

Join SSC Daily Quiz Telegram Group

39. **Which two signs should be interchanged to make the following equation correct?**
$13 \times 2 - (8 \div 4) + (4 \times 1) = 24$

A $+$ and $\div$

B $+$ and $-$

C $-$ and $\times$

D $+$ and $\times$

Answer: B

40. **Select the option in which the numbers are related in the same way as are the numbers of the following set.**
(7, 12, 18)

A (6, 12, 15)

B (4, 6, 8)

C (5, 9, 11)

D (8, 14, 21)

Answer: D

41. **Select the option that is related to the third number in the same way as the second number is related to the first number.**
8 : 69 : : 7 : ?

A 56

B 57

C 54

D 55

Answer: C

42. **Find the number of triangles in the given figure.**

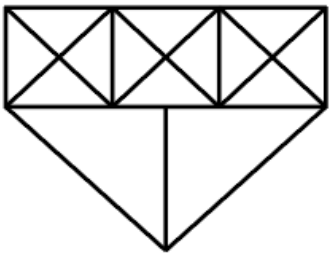

A 29

B 31

C 27

D 33

Answer: B

Downloaded from cracku.in

43. **Select the correct mirror image of the given combination when the mirror is placed at 'PQ' as shown.**

A

B

C

D

Answer: C

44. **Select the figure that will replace the question mark (?) in the following figure series.**

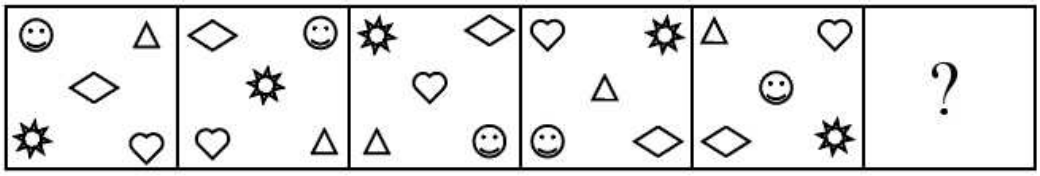

A 

B 

C 

D 

Answer: B

SSC CHSL Free Mock Test

Downloaded from cracku.in

45. **Study the given pattern carefully and select the number that can replace the question mark (?) in it.**

4	10	16
6	4	13
8	?	26

A 18

B 14

C 12

D 16

Answer: B

46. **2 train tickets from Mohali to Delhi and 3 tickets from Mohali to Jammu cost ₹800. But 3 tickets from Mohali to Delhi and 2 tickets from Mohali to Jammu cost ₹700. What are the ticket prices for Delhi and Jammu, respectively, from Mohali?**

A ₹100, ₹200

B ₹200, ₹200

C ₹100, ₹150

D ₹200, ₹100

Answer: A

47. **U's daughter, X, is the daughter-in-law of V. W is the son of V's daughter. How is W related to X?**

A Brother-in-law

B Father-in-law

C Nephew

D Cousin

Answer: C

SSC CHSL Prevoius Papers (DOWNLOAD PDF)

48. **In a certain code language, INHALE is coded as 110 and DELAY is coded as 86. How will IGNORE be coded in that language?**

A 93

B 95

C 91

D 94

Answer: C

49. **Select the Venn diagram that best represents the relationship between the following classes.**
Telugu, Urdu, Poetry

Downloaded from cracku.in

A 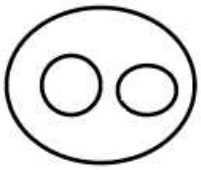

B 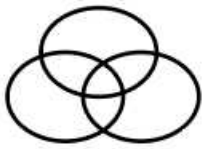

C 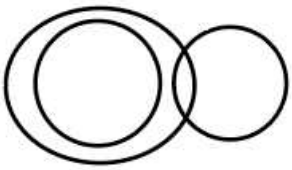

D 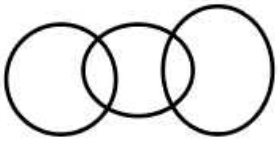

Answer: D

50. **Select the combination of letters that when sequentially placed in the blanks of the given series will complete the series.**
h _ c g _ h k _ g l _ k c _ l

A c h l k g

B g h l c k

C k l c h g

D l g k h c

Answer: C

SSC CGL Previous Papers (DOWNLOAD PDF)

Quantitative Aptitude

Downloaded from cracku.in

51. Study the following bar graph and answer the question that follows.

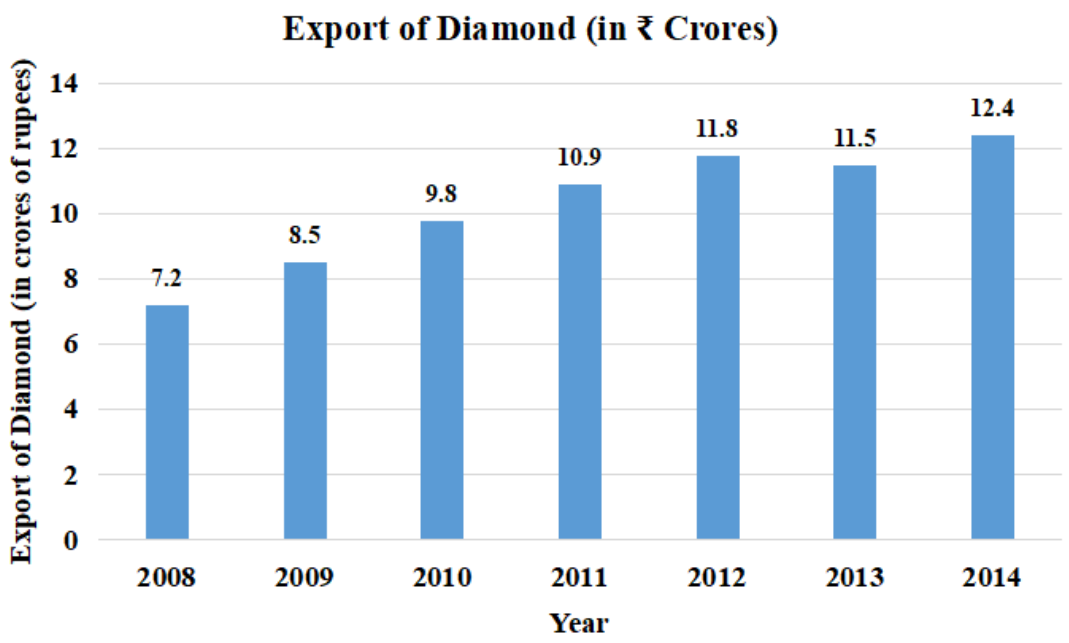

The average export of diamonds for the given period (in ₹ crores) was:

A 10.1

B 10.3

C 10.4

D 10.2

Answer: B

SSC CGL Free Mock Test (Latest Pattern)

52. If $x - y = \frac{7}{4}$ and $\frac{1}{x} - \frac{1}{y} = \frac{14}{3}$, then $x^3 - y^3$ is equal to:

A $\frac{433}{32}$

B $\frac{433}{64}$

C $\frac{217}{64}$

D $\frac{217}{32}$

Answer: C

53. If $a^4 + b^4 + a^2b^2 = 133$ and $a^2 + b^2 - ab = 19$, then the value of ab will be:

A -9

B -6

C 12

D 15

Answer: B

Downloaded from cracku.in

54. **The value of** $18 \div 6 of 9 \times [12 \div 3 of \{16 \times 2 \div (11-8)\}] of (4 \div 2 of 8)$ **is:**

A $\frac{9}{16}$

B $\frac{3}{8}$

C $\frac{1}{32}$

D $\frac{81}{32}$

Answer: C

SSC CHSL Important Questions and Answers (Download PDF)

55. **A sum of ₹12,992 is divided among A, B and C such that the ratio of the shares of A and C is 4: 15 and that of the shares of A and B is 2 : 5. Thedifference (in ₹) between the shares of B and is:**

A 3,136

B 2,240

C 2,688

D 1,792

Answer: B

56. **If** $3\cos^2\theta - 4\sin\theta + 1 = 0, 0^\circ < \theta < 90^\circ$**, then the value of** $3\cos^2\theta + 5\tan^2\theta$ **will be:**

A $5\frac{1}{5}$

B $5\frac{2}{3}$

C $5\frac{4}{5}$

D $6\frac{2}{3}$

Answer: B

57. **A sum of ₹ x amounts to ₹8,563.50 in** $3\frac{1}{2}$ **years and to ₹10,527 in 7 years at y % p.a. simple interest. The value of x and y, respectively, are**

A 6600 and 8

B 6800 and $8\frac{1}{2}$

C 6600 and $8\frac{1}{2}$

D 7000 and 8

Answer: C

SSC CHSL Study Material

58. **Savita spends 20% of her monthly income on groceries, 15% of the remaining onrent and then 60% of the left over on children's education and others. If she saves ₹9,792 a month, then how much(in ₹) does she spend on rent?**

Downloaded from cracku.in

A 3,960

B 4,450

C 4,200

D 4,320

Answer: D

59. **The marked price of an article is ₹ x . After allowing two successive discounts of 20% and 16%on the marked price, it is sold for ₹504. Whatis the value of x ?**

A 720

B 700

C 740

D 750

Answer: D

60. **The average marks obtained by 150 students in a certain examinationis 50. If the average marks of the passed students are 54 and that of the students whofailed are 30, then what will be the number of the students who failed?**

A 25

B 24

C 20

D 28

Answer: A

SSC CHSL Free App

61. **The perimeters of $\triangle ABC$ and $\triangle DEF$ are 39.6 cm and 26.4 cm, respectively, and $\triangle ABC \sim \triangle DEF$. What is the ratio of the areas of $\triangle ABC$ and $\triangle DEF$?**

A 3 : 2

B 9 : 4

C 16 : 9

D 9 : 2

Answer: B

62. **By selling an article at $\frac{7}{12}$ of its selling price, a man loses 16%. If he sells it at 90% of its original selling price, then what will be the profit percentage?**

A 29.6%

B 26.4%

C 32.5%

Downloaded from cracku.in

D 30.2%

Answer: A

63. **In $\triangle PQR, \angle PQR = 135^\circ, PQ = 8\sqrt{2}$ cm and PR = 17 cm. What is the length(in cm) of QR?**

A 7

B 10

C 8

D 9

Answer: A

Daily Free SSC Practice Set

64. **If $x^2 - 5\sqrt{2}x - 1 = 0$, then what will be the value of $x^3 - \frac{1}{x^3}$?**

A $250\sqrt{2}$

B $255\sqrt{2}$

C $485\sqrt{2}$

D $265\sqrt{2}$

Answer: D

65. **Pipes A and B can empty a full tank in 36 and 45 minutes, respectively, whereas pipe C alonecan fill the tank in 15 minutes. B and C are opened together for 15 minutes, and then both are turned off and A is opened. Pipe A will empty the tank in (in minutes):**

A 30

B 18

C 20

D 24

Answer: D

66. **PQRS is a cyclic quadrilateral with QR as the diameterofthe circle. If $\angle SQR = 24^\circ$, then what will be the measure of $\angle QPS$?**

A 114°

B 126°

C 104°

D 116°

Answer: A

Free SSC Study Material (18,000 Solved Questions)

Downloaded from cracku.in

67. **Trains A and B of 15lengths 329 m and 296 m. respectively, are running in opposite directions on parallel tracks, at the speeds of 85 km/h and 65 km/h, respectively. In what time (in seconds) will they cross each other?**

A 15

B 15.5

C 14

D 16.5

Answer: A

68. **Study the given graph and answer the question the follows.**

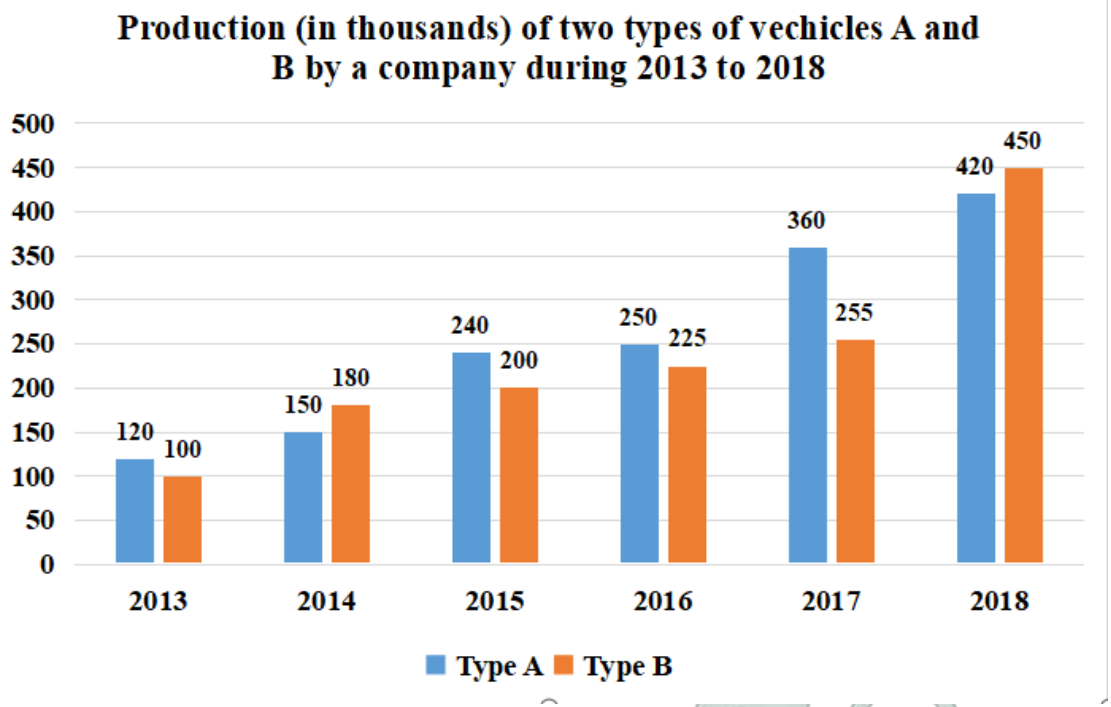

In 2019, if the production of vehicles of type A increased by the same percentage as that in 2018, over its previous year, then what was the number(in thousands) of vehicles of type A produced in 2019?

A 490

B 510

C 500

D 480

Answer: A

Downloaded from cracku.in

69. Study the given graph which shows the target and actual production of ACs (in thousands) of a factory over five months and answer the question that follows.

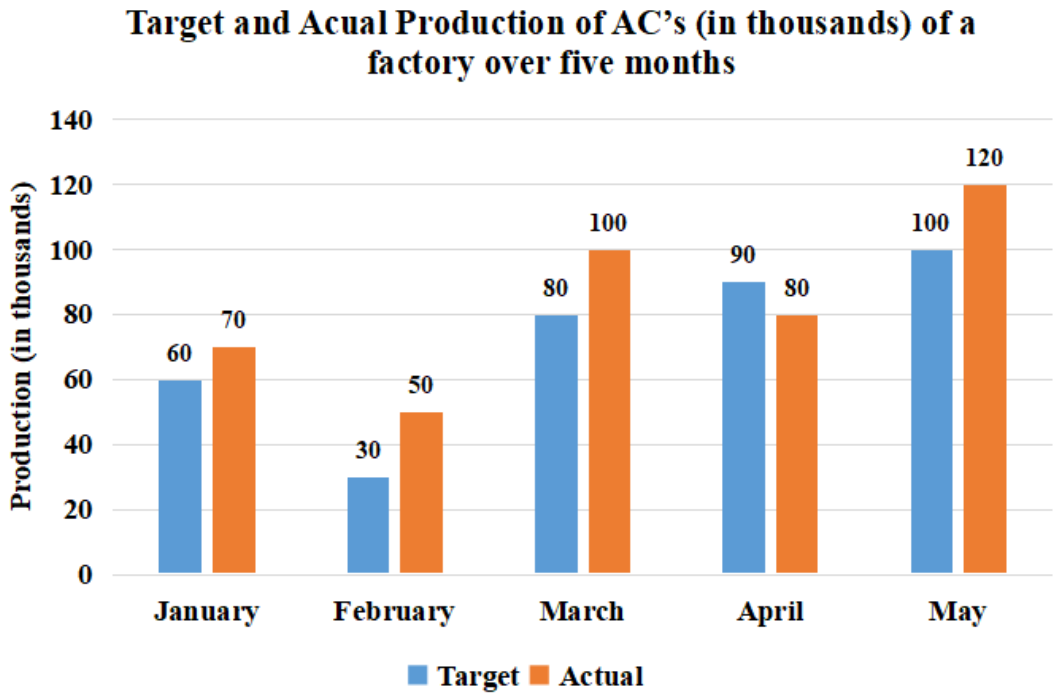

The actual production of ACs in February is what per cent less than the average target production of ACs over the period of five months (correct to the nearest integer)?

A 30%

B 32%

C 29%

D 31%

Answer: D

1500+ Very Important Free SSC Solved Questions

70. If $\sin\theta = \frac{2\sqrt{ab}}{a+b}$, $a > b > 0$, then the value of $\frac{\cos\theta+1}{\cos\theta-1}$ will be :

A $-\frac{b}{a}$

B $-\frac{a}{b}$

C $\frac{a}{b}$

D $\frac{b}{a}$

Answer: B

71. The length of a rectangle is 10 cm morethan the side of a square and its breadth is 8 cm less than the side of the square. If the areas of both the rectangle and square are equal, then what will be the perimeter (in cm) of the rectangle?

A 164

B 160

C 156

Downloaded from cracku.in

D 144

Answer: A

72. **If the nine-digit number 48x4923y8 is divisible by 88, then the value of (6x + 5y) for the maximum valueof y, will be:**

A 76

B 72

C 65

D 71

Answer: B

SSC Exam Update Videos & Free Study Material (YouTube Channel)

73. **The value of** $\frac{3\cos^2 27^\circ - 5 + 3\cos^2 63^\circ}{\tan^2 32^\circ + 4 - \operatorname{cosec}^2 58^\circ} + \sin 35^\circ \cos 55^\circ + \cos 35^\circ \sin 55^\circ$ **is:**

A $-\frac{1}{4}$

B $-\frac{1}{3}$

C $\frac{1}{3}$

D $1\frac{2}{3}$

Answer: C

74. **Study the given graph and answer the question that follows.**

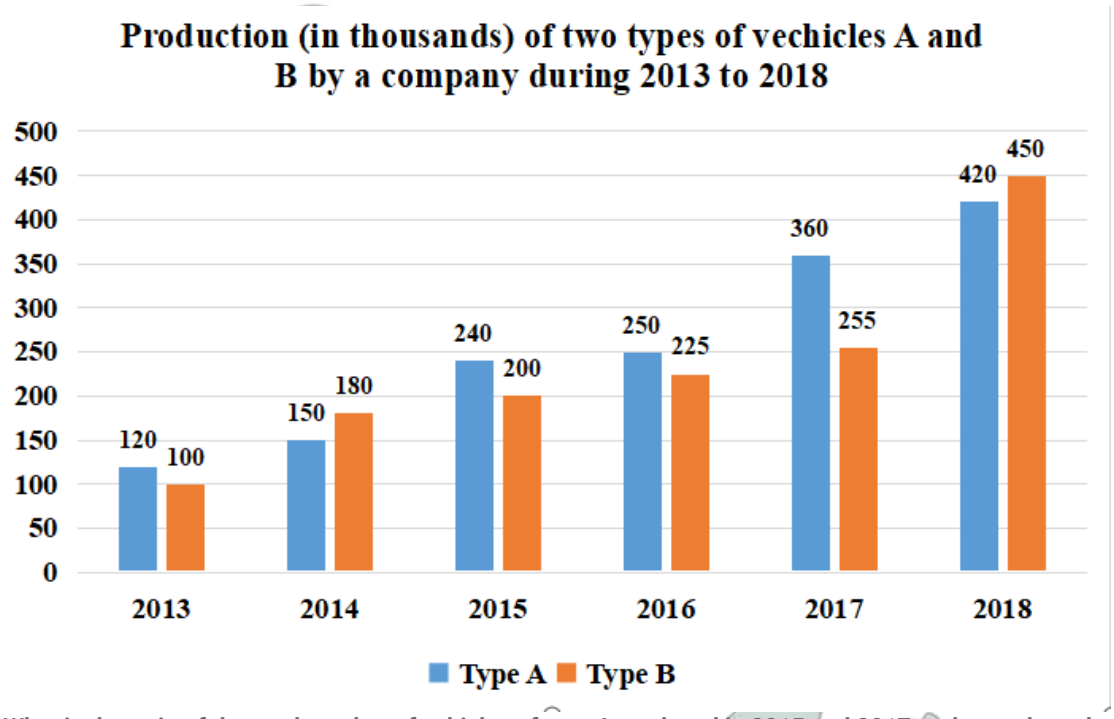

What is the ratio of the total number of vehicles of type A produced in 2015 and 2017 to the total number of vehicles of type B produced in 2016 and 2017?

A 4:3

Downloaded from cracku.in

B 5:4

C 5:3

D 3:2

Answer: B

75. **Chords AB and CD of a circle are produced to meetat the point P, outside the circle, and AD is the diameter of the circle. If $\angle DAP = 36^\circ$ and $\angle APC = 30^\circ$, then what will be the measure of $\angle CBD$?**

A 34°

B 26°

C 24°

D 16°

Answer: C

Latest Job Updates on Telegram - Join here

General Awareness

76. **A _____ is a computer programme which can self-replicate and propagate over the network with or without human intervention and has malicious intent.**

A kernel

B virus

C trojan horse

D worm

Answer: D

Join SSC Daily Quiz Telegram Group

77. **A government budget is an annual financial statement which outlines estimated government expenditures and expected government receipts or revenues for the forthcoming fiscal year. Depending on the feasibility of these estimates which of the following is NOT the budget type?**

A Deficit budget

B Balanced budget

C Economy budget

D Surplus budget

Answer: C

78. **When did the peasant movement in Bardoli begin?**

A 1928

Downloaded from cracku.in

B 1934

C 1919

D 1943

Answer: A

79. **On which of the following dates is the Good Governance Day observed in India every year?**

A 12 September

B 4 October

C 25 December

D 5 July

Answer: C

80. **ICAR is an autonomous body responsible for coordinating agriculture and research in India. What is the full form of ICAR?**

A Institute of Central Aviation Research

B Indian Centre of Agriculture and Research

C Indian Council of Agricultural Research

D Institute of Central Agricultural Research

Answer: C

81. **Where has Kiren Rijiju, Union Minister for Youth and Sports, launched the Assam Rifles Public School as the first sports school announced under Khelo India Scheme?**

A Guwahati

B Nagaon

C Shillong

D Dispur

Answer: C

82. **Where did Union Minister of Earth Sciences Dr. Harsh Vardhan virtually inaugurate India's highest Meteorological Centre?**

A Shillong

B Leh

C Guwahati

D Shimla

Answer: B

Downloaded from cracku.in

83. **_____ is a set of norms and guidelines to be followed by the political parties and contesting candidates during election time.**

A Constitutional Norms

B Constitutional Rules

C Code of Conduct

D Rigging

Answer: C

84. **Pt. Satish Vyas was conferred upon the prestigious Tansen Samman in December 2020. He was associated with which of the following musical instruments?**

A Flute

B Harmonium

C Santoor

D Tabla

Answer: C

85. **Which of the following is not a good conductor of electricity?**

A Graphite

B Gold

C Diamond

D Soil

Answer: C

SSC CHSL Prevoius Papers (DOWNLOAD PDF)

86. **Who among the following Sikh Gurus laid the foundation of 'Khalsa Panth'?**

A Guru Gobind Singh

B Guru Arjan Dev

C Guru Teg Bahadur

D Guru Nanak Dev

Answer: A

87. **Who among the following has been awarded the Bharathi award 2020?**

A Raj Kamal

B Seeni Viswanathan

C Vidyut Mohan

D Ratan Tata

Downloaded from cracku.in

Answer: B

88. **Who among the following has become the Chief Justice of Orissa High Court in January 2021?**

A S Muralidhar

B Pankaj Mithal

C Sanjib Banerjee

D Hima Kohli

Answer: A

SSC CGL Previous Papers (DOWNLOAD PDF)

89. **Which of the following rivers does NOT culminate in the Arabian Sea?**

A Sabarmati

B Tapti

C Indus

D Godavari

Answer: D

90. **Big Bang theory explains:**

A origin of Universe

B origin of Stars

C origin of Galaxies

D origin of Solar System

Answer: A

91. **Who among the following is the brand ambassador of Equitas Small Finance Bank (ESFB)?**

A Virat Kohli

B Rohit Sharma

C Mithali Raj

D Smriti Mandhana

Answer: D

SSC CGL Free Mock Test (Latest Pattern)

92. **Who among the following women cricketers has won the ICC Associate Player of the Decade award in 2020?**

A Kathryn Bryce

Downloaded from cracku.in

B Stafanie Taylor

C Sarah Bryce

D Mithali Raj

Answer: A

93. **_____ are built up by the liquid and solid rock erupting from the earth's interior.**

A Volcanoes

B Fault-block mountains

C Erosional mountains

D Plateaus

Answer: A

94. **Amino acids are often referred to as the building blocks of _____.**

A sugar

B carbohydrates

C fats

D proteins

Answer: D

SSC CHSL Important Questions and Answers (Download PDF)

95. **Hampi was declared as a World Heritage Site by UNESCO in which of the following years?**

A 1999

B 1980

C 1990

D 1986

Answer: D

96. **Who has become the new chief of the Central Industrial Security Force (CISF) in January 2021?**

A Rajan Datta

B Kumar Rajesh Chandra

C Subodh Kumar Jaiswal

D Rajesh Ranjan

Answer: C

97. **A User Interface is the part of _____ that allows the user to enter and receive information.**

Downloaded from cracku.in

A computer network

B operating system

C computer hardware

D data science

Answer: B

SSC CHSL Study Material

98. **The world's oldest first-class cricketer and World War II veteran, Alan Burgess passed away in January 2021. He represented which of the following countries?**

A Australia

B England

C New Zealand

D Spain

Answer: C

99. **On which of the following idols of Hindu mythology has Italian screenwriter-film producer Alfredo Covelli authored 'Vahana Masterclass', a book for kids?**

A Lord Vishnu

B Lord Ganesha

C Lord Shiva

D Lord Krishna

Answer: B

100. **Which type of dam is a temporary dam constructed to exclude water from the specific area?**

A Coffer

B Impounding

C Detention

D Debris

Answer: A

SSC CHSL Free App

SSC CHSL Free Mock Test

Downloaded from cracku.in

SSC CHSL Prevoius Papers (DOWNLOAD PDF)

SSC CGL Previous Papers (DOWNLOAD PDF)

SSC CGL Free Mock Test (Latest Pattern)

SSC CHSL Important Questions and Answers (Download PDF)

SSC CHSL Study Material

SSC CHSL Free App

Daily Free SSC Practice Set

Free SSC Study Material (18,000 Solved Questions)

1500+ Very Important Free SSC Solved Questions

SSC Exam Update Videos & Free Study Material (YouTube Channel)

Latest Job Updates on Telegram - Join here

Join SSC Daily Quiz Telegram Group

Downloaded from cracku.in